Name: _____

Sr: 30092023-3212

September 30, 2023

MATHS WORKSHEET GENERATOR 11-PLUS SATS GCSES

1) Round 4.132634 to 1 decimal places.

Answer: _____

2) 05:38 am To 08:28 am

Answer: _____

3) Round 14.339 to 1 significant figures.

Answer: _____

4) $^{8}/_{10} + {}^{6}/_{11}$

Answer: _____

5)



Find the Angle at side A.

Answer: _____

6) A number is chosen at random from 1 to 25. Find the probability of selecting multiples of 8.

Answer: _____

7)

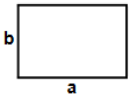

Find area of rectangle having sides a = 93 cm and b = 86 cm

Answer: _____

8) $^{11}/_{7} - {}^{5}/_{12}$

Answer: _____

9) Convert the following fraction into a mixed number: $^{10}/_{6}$

Answer: _____

10) (-96) ÷ 6

Answer: _____

11) 182.04 ÷ 14.8

Answer: _____

12) **3** $^{3}/_{4}$ **- 6** $^{1}/_{2}$

Answer: _____

13) Find the next three numbers in the sequence 4,0,0,-4,-4,-8,-8__,__,__

Answer: _____

14)

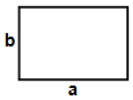

Find area of rectangle having sides a = 100 ft and b = 88 ft

Answer: _____

15) $^{15}/_{1} - {}^{7}/_{2}$

Answer: _____

Copyright 2023 - Geek School Tutoring Limited

Name: _____

Sr: 30092023-3212

September 30, 2023

16) 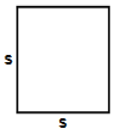

Find perimeter of square having each side (s) equals 13 in

Answer: _____

17) 'What is the probability of rolling a even prime number.when rolling a dice

Answer: _____

18) 21.7 x 28.6

Answer: _____

19) 40 ÷ 4

Answer: _____

20) 9 + 77

Answer: _____

Total: ___ / 20

Copyright 2023 - Geek School Tutoring Limited

Name: _____

Sr: 30092023-3212

September 30, 2023

Answers:

1) 4.1	2) 02 Hours 50 Mins	3) 10	4) $1^{19}/_{55}$	5) 135	6) $^{3}/_{25}$	7) 7998cm
8) $1^{13}/_{84}$	9) $1^{2}/_{3}$	10) -16	11) 12.3	12) $5^{3}/_{4}$	13) -12,-12,-16,	14) 8800ft
15) $11^{1}/_{2}$	16) 52in	17) $^{1}/_{6}$	18) 620.62	19) 10	20) 86	

Copyright 2023 - Geek School Tutoring Limited